Math Intervention

The Number System

130 pages of resources!

Assesses Procedural & Conceptual Understanding

TANYA YERO Teaching

Sixth Grade Pack

THANK YOU FOR YOUR PURCHASE!

CONNECT WITH ME!

TERMS OF USE

Copyright © Tanya Yero. All rights reserved by creator. This product is to be used by the original downloader only. Copying for more than one teacher, classroom, team, grade level, department, school, or school system is prohibited. This product may not be distributed or displayed digitally for public view. Failure to comply is a copyright infringement and a violation of the Digital Millennium Copyright Act (DMCA). Clipart and elements found in this PDF are copyrighted and cannot be extracted and used outside of this file without permission or license. Please contact me if you wish to be granted special authorizations.

YOU MAY:

- Use this item for personal use. The purchase of this product is good for one classroom.
- Review, pin, and/or provide feedback of this product online. Please include a link.
- Purchase additional licenses or share store link with others and/or online.

YOU MAY NOT:

- Make copies, email, and/or share this resource
- Post this resource or any portion of this product online.
- Share, sell, or claim this product as your own.
- Use any part of this product when creating your own resources for sale online.

CHECK OUT MY OTHER PRODUCTS!

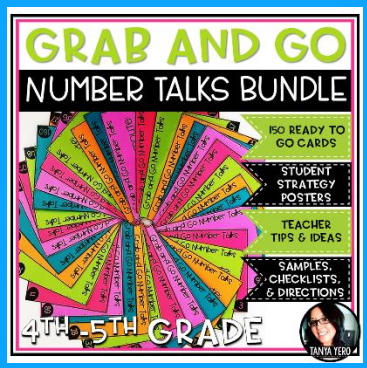



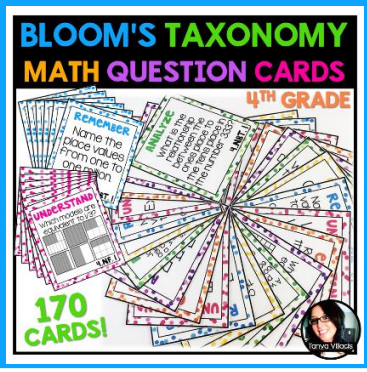

How to use the materials included

Pretest and Item Analysis sheet is designed to pin point exactly where your students' needs are.

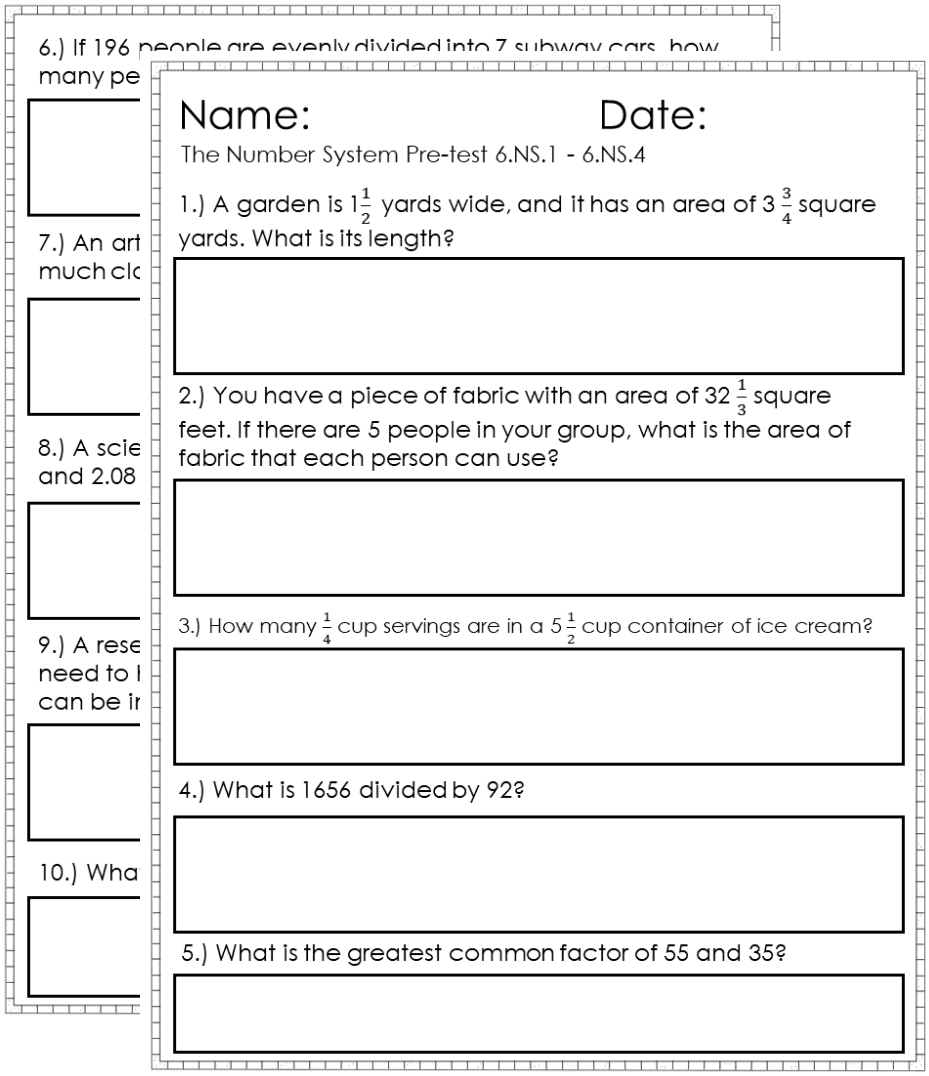

Name: Date:

The Number System Pre-test 6.NS.1 - 6.NS.4

1.) A garden is $1\frac{1}{2}$ yards wide, and it has an area of $3\frac{3}{4}$ square yards. What is its length?

2.) You have a piece of fabric with an area of $32\frac{1}{3}$ square feet. If there are 5 people in your group, what is the area of fabric that each person can use?

3.) How many $\frac{1}{4}$ cup servings are in a $5\frac{1}{2}$ cup container of ice cream?

4.) What is 1656 divided by 92?

5.) What is the greatest common factor of 55 and 35?

Item Analysis Data Sheet Per Student

The Number System Pre-test 6.NS.1 - 6.NS.4

Student Name: _____

?'s	Standard	Procedural Understanding	Conceptual Understanding	(M) Missed
#1	6.NS.1		X	
#2	6.NS.1		X	
#3	6.NS.1	X		
#4	6.NS.2	X		
#5	6.NS.4	X		
#6	6.NS.2	X		
#7	6.NS.2		X	
#8	6.NS.3		X	
#9	6.NS.3		X	
#10	6.NS.4	X		

Printables are included for reviewing procedural and conceptual understanding for each standard/topic.

Resources for every step of intervention!

Name:

The Number System Pre-test 6.NS.1 -

1.) A garden is $1\frac{1}{2}$ yards wide, and i
yards. What is its length?

2.) You have a piece of fabric with
feet. If there are 5 people in your g
fabric that each person can use?

3.) How many $\frac{1}{4}$ cup servings are in a $5\frac{1}{2}$

4.) What is 1656 divided by 92?

5.) What

Item Analysis Data Sl

The Number System Pre

Student Name: _____

?'s	Standard	Procedural Understanding
#1	6.NS.1	
#2	6.NS.1	
#3	6.NS.1	X
#4	6.NS.2	X
#5	6.NS.4	X
#6	6.NS.2	X
#7	6.NS.2	
#8	6.NS.3	
#10	6.NS.4	X

Item Analysis Data Sheet for Class

The Number System Pre-test 6.NS.1 - 6.NS.4

Student Initials go in top row. X means the student missed the question.

Quick Check Assessment Data Graph

The Number System Pre-test 6.NS.1 - 6.NS.4

Student Name: _____

Intervention time spent:

Pre-test score:

Post-test score:

Notes:

Nam

6.NS.2 Pra

1.) Fill in the blank with the correct number:

There are _____ 43s in 731.

3.) Fill in the blank with the correct number:

There are _____ 24s in 1,032.

5.) Fill in the blank with the correct number:

There are _____ 19s in 266.

Name

1.) If a teacher has 414 stickers and 23 students, how many stickers can each student be given?

3.) A teacher has 1846 credits for a virtual online store. If he has 26 students, how many credits can he give to each student?

5.) A concession stand at a stadium has ordered 3558 donut holes. If there are 593 people attending a game, how many donut holes can each person order?

1.) A school receives a shipment of 12, paper. It is divided equally among the each classroom has 28 students, how student have?

2.) A bakery owner has 3087 blueberrie of muffins and each box will have 9 mu will there be in each muffin?

3.) A researcher is conducting interviev allotted to conduct the interviews. If e and each person needs to be interviev does she have time to interview?

4.) A subway has a capacity of 4624 p trains and each train has 8 cars, how n

5.) A festival sells 1482 tickets to ride the wheel has 13 cars and each car holds will the Ferris wheel have to run so that ride it?

1.) 20,976 ÷ 69 =

2.) 1,372 ÷ 49 =

3.) A doctor has an eight-hour workday and has 32 patients to see. How long can she spend with each patient?

4.) A school gets an order of 345 new tablets. If there are 23 classrooms, how many tablets can be placed in each classroom?

5.) A candle factory has 3698 ounces of hot wax ready. If they use 43 ounces for each candle, how many candles can they make?

TANYA YERO Teaching

WHERE creativity MEETS PRACTICALITY

THANK You

for downloading this product!



Follow Me

on TpT for notifications on my latest products and freebies!

OTHER PLACES TO FIND ME:

Copyright © Tanya Yero. All rights reserved by creator. This product is to be used by the original downloader only. Copying for more than one teacher, classroom, team, grade level, department, school, or school system is prohibited. This product may not be distributed or displayed digitally for public view. Failure to comply is a copyright infringement and a violation of the Digital Millennium Copyright Act (DMCA). Clipart and elements found in this PDF are copyrighted and cannot be extracted and used outside of this file without permission or license. Please contact me if you wish to be granted special authorizations.